NYERI COUNTY EVALUATION TEST

STD 4

END TERM 2

SOCIAL STUDIES & CRE

Time:2hrs 15min

Study the map below and answer Question 1-7.

MAVUNO AREA

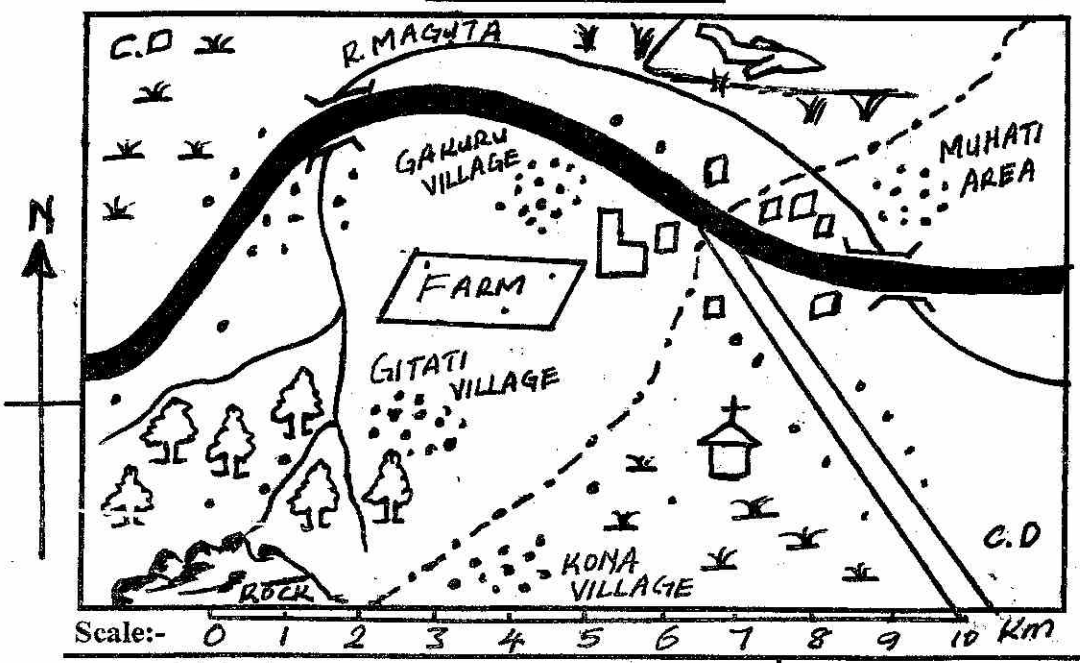

Key:-

C.D	Cattle dip
	District boundary
	River
	All weather road
	Dry weather road
	School
	Settlement
	Permanent buildings
	Forest
	Scrubs
	Air strip
	Church

1. Which is the lowest area in Mavuno area?
   A. Kona village B. Gitati village
   C. Muhati area D. Gakuru village
2. Mavuno area is likely to be a _____
   A. District B. County
   C. Province D. Country
3. The airstrip in Mavuno area is likely to carry:
   A. cattle B. tourists
   C. fruits D. fish
4. What is the direction of the airstrip from the church?
   A. South B. East
   C. North D. West
5. River Maguta has _____tributaries.
   A. four B. one
   C. three D. two
6. People of Mavuno area are_____
   A. christians B. hindus
   C. muslims D. pagans
7. The main means of transport in Mavuno area is _____
   A. water B. road
   C. air D. on foot
8. A long chain of hills are called _____
   A. aberdare B. mountain
   C. ranges D. forest
9. The following rivers have their source in Aberdare ranges **except:-**
   A. Ragati B. Moyok
   C. Honi D. Chania
10. The **main** type of trees found in Scrub vegetation is:-
    A. cactus B. marshes
    C. baobab D. acacia
11. The County bordering Nyeri County to the East is _____
    A. Murang'a B. Kirinyaga
    C. Laikipia D. Nyandarua
12. The _____ part of Nyeri County is covered by grassland.
    A. Northern B. Central
    C. Eastern D. Southern
13. The arrow of the windvane points where the wind is blowing _____
    A. after B. to
    C. from D. against
14. The compass direction marked **V** is _____

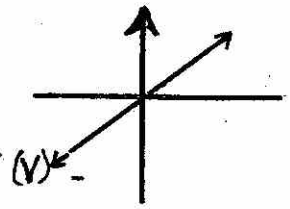

A. North East B. South East
C. South West D. North West

15. Which one of the following is the odd one out?
A. Aembu B. Abaluhya
C. Taita D. Maasai

16. Areas that have high population like towns are said to be _____populated.
A. thinly B. densely
C. highly D. sparsely

17. The way of life of people in different communities in the Country is called _____
A. ceremonies B. dressing
C. culture D. moral values

18. The following are festivals **except:-**
A. drama B.naming
C. harvest D. music

Use the map below to answer questions 19-21

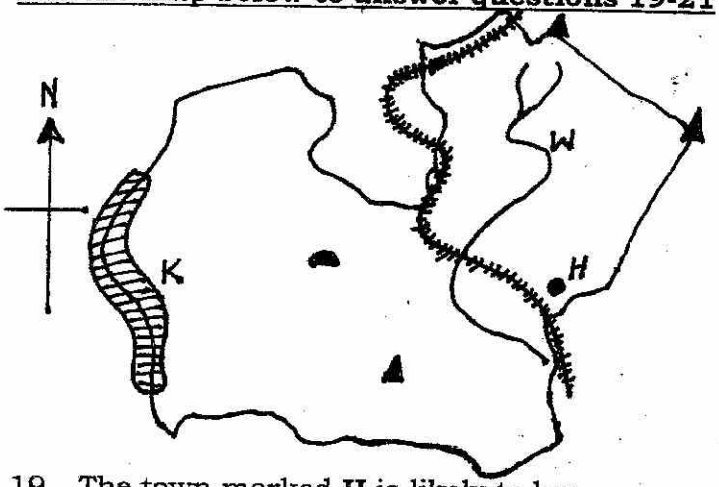

19. The town marked **H** is likely to be:-
A. Nyeri B. Naromoru
C. Karatina D. Othaya

20. The river marked **W** is _____
A. Thuti B. Sagana
C. Honi D. Gura

21. The shaded area marked **K** is _____
A. Kabiru -ini B. Aberdare
C. Mt. Kenya D. Chinga dam

22. Which one of the following physical features is not found in our country?
A. Lake B. Valley
C. Dam D. Forest

23. Most of the rivers in our county drain to river _____
A. Gura B. Thuti
C. Mathioya D. Sagana

24. Tumutumu hill is found in which district ?
A. Tetu B. Mathira West
C. Mathira East D. Mukurwe-ini

25. Traditional ironworkers were called____
A. carvers B. blacksmiths
C. potters D. traders

26. _____ materials are taken to the industries to make finished products.
A. Leather B. Bad
C. Raw D. Weaving

27. People used _____to weave fabrics and to make baskets and ropes.
A.fibres B. wood
C. clay D. leather

28. The trade where people exchanged goods they had with the ones they did not have is called:-
A. modern trade B. giving trade
C. currency trade D. barter trade

29. Which one of the following is **not** a major trading centre in our county?
A.Kiganjo B. Kiria-ini
C. Kiawara D. Endarasha

30. People who are paid to carry goods are called
A. pack animals B. donkey
C. porters D. taxi

31. Tourism is important because _____
A. visitors come to see us
B. farmers get money after selling their crops to tourist hotels
C. the wild animals get food
D. it helps us to learn English

32. Trading activities were conducted _____in the past.
A. in shops
B. at the chief's office
C. in open-air markets
D. in shops

33. Game reserves are managed by_____
A. policemen
B. District Commissioners
C.Kenya wildlife Service [KWS]
D. Local County government

34. The natural homes of wildlife are called___
A. habitats B. forests
C. museums D. game parks

35. Which one of the following is **not** an example of an airstrip or airfield in our County?
A. Karatina B. Nyaribo
C. Gakawa D. Mweiga

36. The road sign below means:-

A. danger ahead B. no road ahead
C. hospital ahead D. road junction

37. Which one of the following traditional forms of communication is **not** non -verbal?
A. Fire and smoke
B. Ululations
C. Beating of drums
D. Blowing horns

38. Which one of the following tourist attractions is found in both Nyeri and Kirinyaga counties?

A. Gura falls B. Aberdare
C. Mount Kenya D. Chania falls

39. Horticultural crops involves growing of flowers and _____
A. vegetables B. wheat
C. coffee D. pyrethrum

40. The following items were made from leather **except:-**
A. sandles B. spears
C. ropes D. clothes

41. _____ is a person who belongs to a particular Country.
A. Society B. Dweller
C. Citizen D. Kenyan

42. Which one of the following is **not** a traditional industry?
A.Glass making B. Basketry
C. Pottery D. Iron-working

43. Watering of plants where there is little or no rainfall is _____
A. planting B. swamping
C. drying D. irrigation

44. The waterfalls found in our County is ____
A. Gikira falls B. Sagana falls
C. Gura falls D. Thuti falls

45. Gourds for storing milk and water were made from:-
A. Mungu B. calabash
C. pumpkins D. clay

46. _____ is **not** a member of a nuclear family
A. Father B. Mother
C. Uncle D. Children

47. Chicken reared for meat are called _____
A. poultry B. broilers
C. beef farming D. layers

48. _____ is **not** a resource.
A. Soil B. Water
C. Wildlife D. Road

49. The headquarters of our County is in ____ town.
A.Othaya B. Nairobi
C. Nyeri D. Karatina

50. Traditional doctors who collect their medicines from different types of plants are called _____
A. nurses B. herbalists
C. doctors D. witchdoctors

51. Beef cattle are kept in large farms called
A. zero grazing B. paddocks
C. forests D. ranches

52. Rivers that dry up during the dry season are known as _____rivers.
A. permanent B. dry
C. seasonal D. net

53. When we resolve our differences, we live _
A. in peace B. unhappily
C. in poverty D. in sadness

54. The **main** tourist attraction in Aberdare national park is:-
A. beautiful sites B. wildlife
C. traditional food D. traditional dances

55. The major cause of road accident in most roads of our county is _____
A. poor roads
B. use of unroadworthy vehicles
C. careless use of the roads
D. careless traffic officers

56. The weather instrument below is used to measure:-

A. strength of the wind
B. temperature
C. direction of wind
D. amount of rainfall

57. An example of planted forest is found in:-
A. Mount Kenya forest
B. Aberdare forest
C. Karima hill
D. Nyana hill

58. The carrying away of soil by water and wind is called soil _____
A. protection B. cover
C. transport D. erosion

59. Rainfall is measured in _____
A. °C B. mm
C. km D. cm

60. All the plants found in an area are known as
A. vegetation B. vegetables
C. forests D. trees

C.R.E

61. _____ means "The place of the skull"
A. Gethsemane B. Calvary
C. Sinai D. Olives

62. When Jesus raised Lazarus, He showed he had power over _____
A. creation B. death
C. evil D. resurrection

63. "Wherever you go, I will go; wherever you live I will live. Your people will be my people, and your God will be my God. These words were said by Ruth to _____
A. Orpha B. Mahlon
C. Elimelech D. Naomi

64. What was the name of Hannah's son?
A. Samuel B. Joseph
C. David D. Esau

65. _____ would not let Jesus wash his feet?
A. Judas B. Andrew
C. Simon D. James

66. When Jesus fed 4000 people _____ baskets were collected as left overs.
A. 12 B. 3 C. 8 D. 7

67. Adam and Eve had been told by God not to eat fruits from the tree in the middle of the garden because if they ate they would:-
A. die B. be seen
C. not be satisfied D. live forever

68. Who among the following made a good choice
A. Adam B. Anannias
C. Levi D. Sapphira

69. By promising her only son to God Hannah was_____
A. selfish B. unselfish
C. obedient D. unfair

70. Which one of the following is **not** an African Independent church?
A. The Akorino church
B. African Divine church
C. African Inland church
D. The Legio Maria church of Africa

71. Service given by people who do not ask for payment is ____service.
A. voluntary B. emergency
C. christian D. social

72. When Sarah was 99 years old and Abraham 100 years, God gave them a son called____
A. Samuel B. Jacob
C. Ismael D. Isaac

73. Jesus healed the Centurion's servant at____
A. Nazareth B. Galilee
C. Jericho D. Capernaum

74. Which one of the following is not a way of expressing peace in traditional African society?
A. Shaking hands
B. Drinking beer during parties
C. Through marriages
D. Reading together

75. "I will ask the father, and he will send you a helper, who will stay with you for ever" The helper being referred to is:-
A. The holy spirit B. Jesus
C. Mother D. prophet

76. When Peter preached on the day of Pentecost, _____ people believed and were baptized.
A. three hundred B. three thousand
C. thirty D. ten

77. The following are christian communities in Kenya **except:-**
A. The Akorino churches
B. The Presbyterian Church of East Africa
C. The Methodist church
D. Hinduism

78. When Jesus healed the ten lepers, the one who was thankful was a _____
A. jew B. samaritan
C. levite D.priest

79. King Ahab had a wife called:-
A. Deborah B. Naomi
C. Lydia D. Jezebel

80. Angel Gabriel informed Mary about the birth of Jesus. This is called _____
A. Annunciation B. Resurrection
C. Ascension D. Census

81. The Pharisee and the tax collector went to church to pray. In his prayers the pharisee was not _____
A. arrogant B. proud
C. humble D. self-conceited

82. Lazy people in the traditional African communities are mocked through all the following **except:-**
A. songs B. prayers
C. stories D. riddles

83. On his way to school, Kamau, a std 4 boy found a fifty shillings note lying on the road. As a christian what should he do?
A. Give the teacher on duty
B. Buy sweets and share with his friends
C. Take it back to his mother at home.
D. Give it as an offering to the church

84. The early christians did all the following **except:-**
A. hated each other
B. shared meals
C. worshipped together
D. sold their properties

85. Kamau a std 4 boy at Mucharage Primary school can serve in his church by doing all the following **except:-**
A. singing B. reading the bible
C. praying D. stealing

86. Prophet _____prophesied about the birth of the prince of peace.
A. Micah B. Isaiah
C. Joel D. Jeremiah

87. Three of the following are sacred places for the traditional African communities. Which one is not?
A. Church B. Caves
C. Hills D. Mountains

88. _____ is the last book in the old testament while _____ is the last in the new testament.
A. Genesis and Mathew
B. Exodus and Mark
C. Malachi and Revelation
D. Mathew and Numbers

89. We respond to Jesus' salvation by all the following **except:-**
A. hating our enemies
B. showing kindness to others
C. being good to everyone
D. having joy even in difficulties

90. Which one of the following is not a fruit of the Holyspirit?
A. Joy B. Patience
C. Humility D. Anger